Level 2

4/20/19

A Bank Is Helpful

1. Read

2. Answer main idea questions.

Level E



by Katherine Rottman

Illustrated by Alex Wisehart

Bind This End

Copyright © 2020 n2y, LLC. All rights reserved.
Unique Learning System®, April 2020

Kirk has money. Kirk earned money from doing his job. Kirk needs a safe place to keep his money.

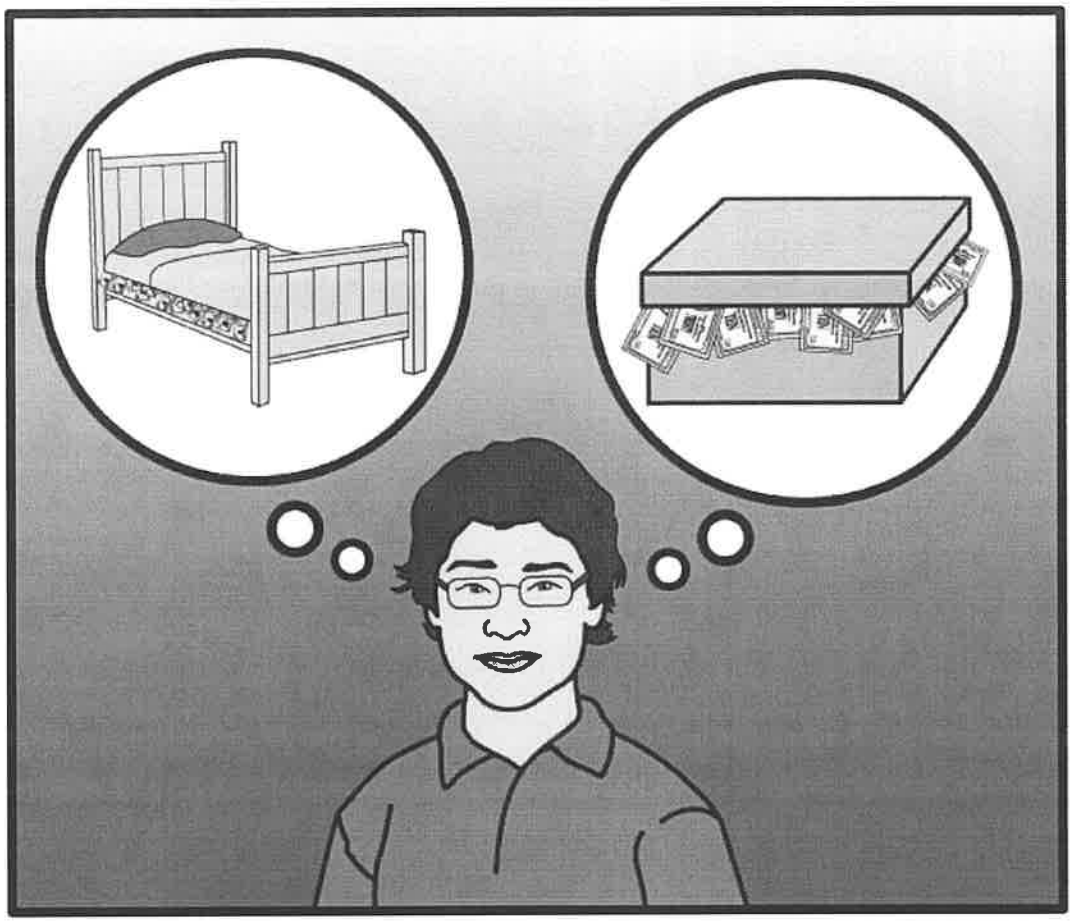

Where should Kirk put his money? Should he put his money under the bed? Should he put his money in a box?



Kirk asks his mother where he can keep his money. She tells Kirk to put his money in a bank. Many people keep their money in a bank.



A bank is a safe place. Kirk's money will be safe until he needs or wants it. A bank is helpful. It can help Kirk do many things with his money.

Kirk and his mother go to the bank. They walk up to the counter. Kirk's mother helps him open up bank accounts.

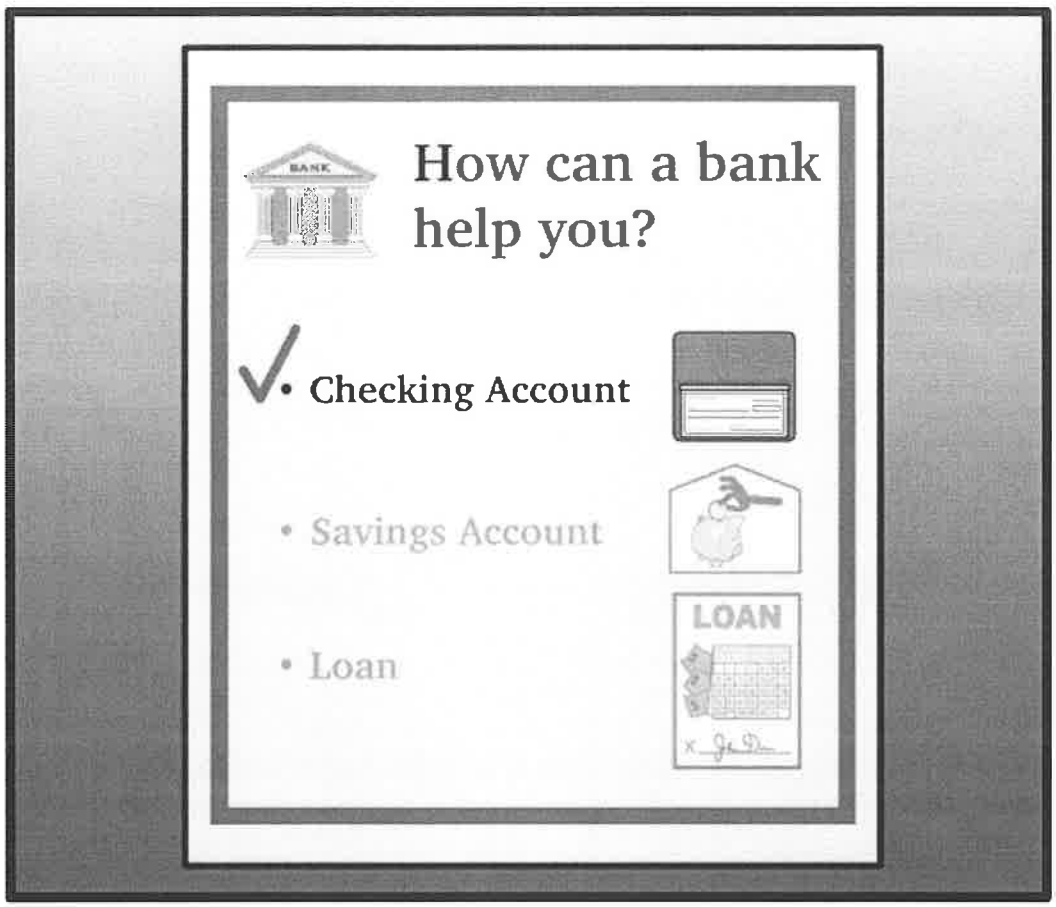

Kirk puts some money into a checking account. The bank keeps the money safe until Kirk wants to spend it. A bank is helpful.



Kirk can use money from the checking account to buy things. He can use a check to pay for them. Checks work like cash.



Kirk can use a debit card to pay for things. A debit card works like cash. It uses money from Kirk's checking account.

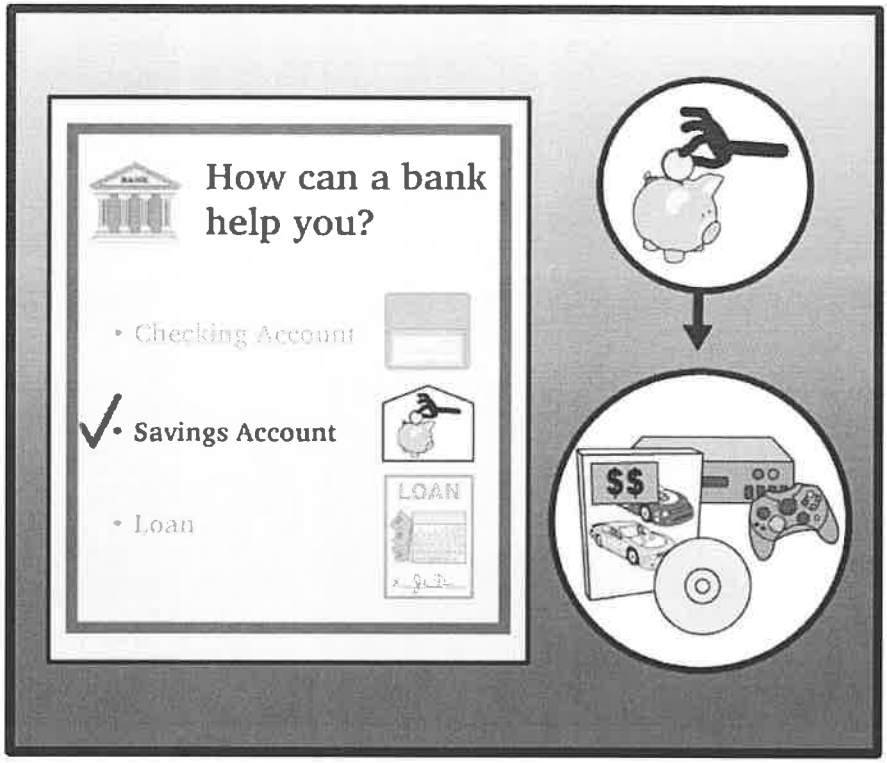

Kirk puts some money into a savings account. Kirk can save money for the big things he wants. The bank keeps the money safe until Kirk wants to spend it.

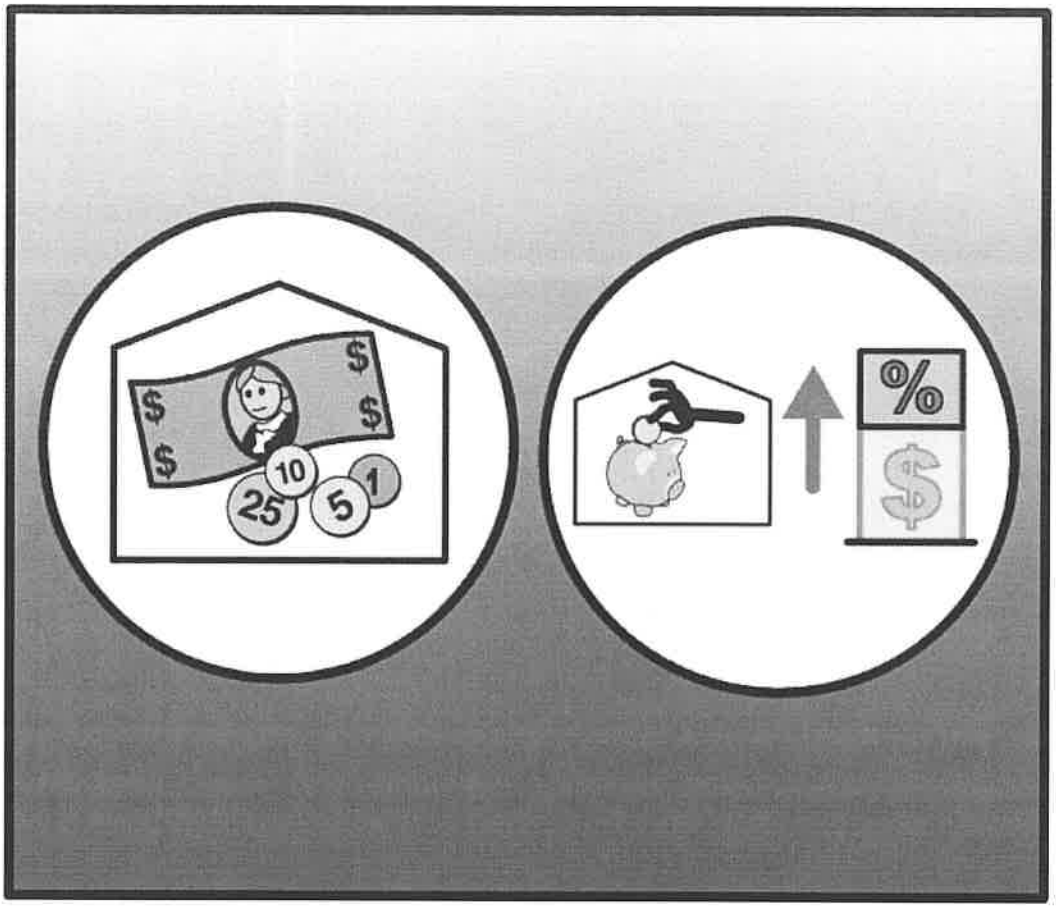

A savings account can earn money. Kirk keeps his money in the bank. The bank adds money to the savings account. A bank is helpful.

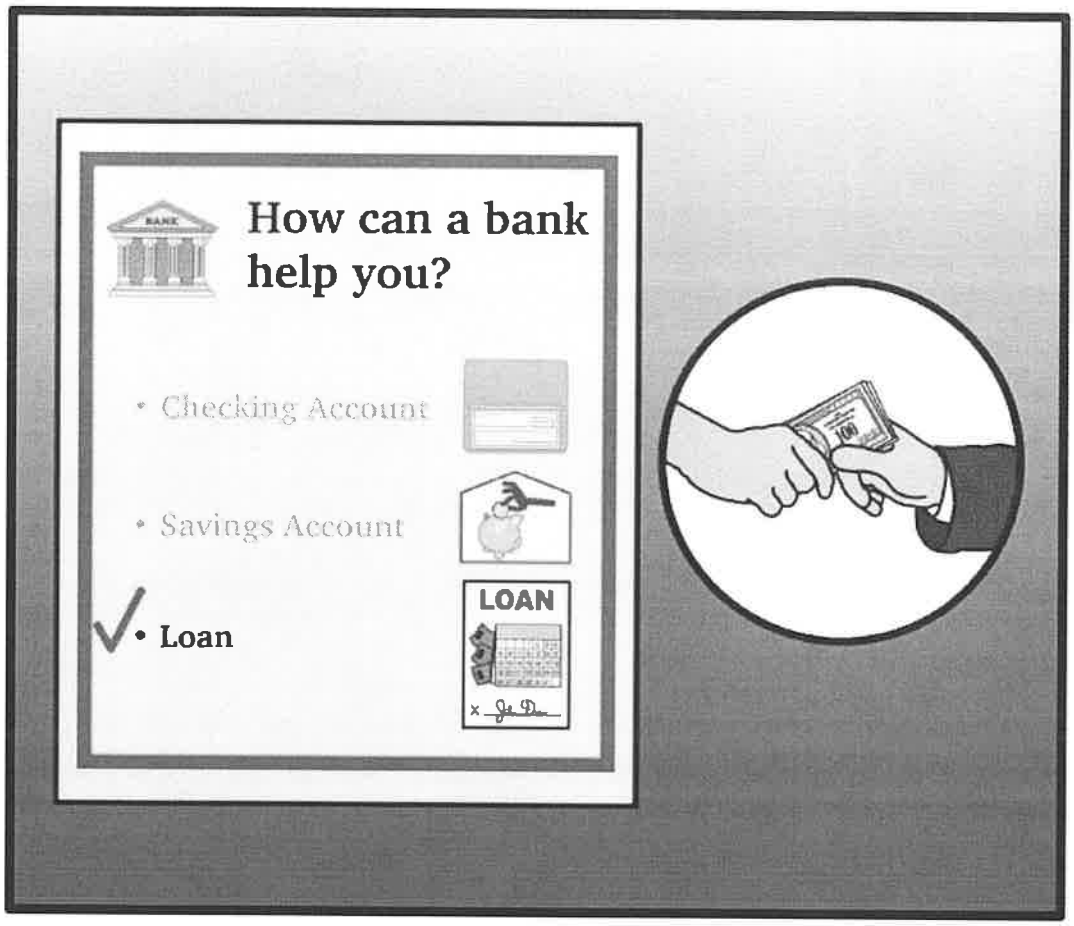

Banks give people loans. People can spend the money now. Then, they pay the money back later. A bank is helpful.



Kirk is glad he put his money in the bank. The bank will keep his money safe. The bank helps Kirk save and spend his money. Now, Kirk knows a bank is helpful.

Main Idea and Key Details

Who is the main character in this story?

a. Mr. Effler b. Eve c. Kirk

What is this story about?

- ◯ a. Kirk puts his money in the bank.
- ◯ b. Kirk has dinner at the restaurant.
- ◯ c. Kirk goes to the movies.

Events	
First	
Next	
Last	

Important Idea or Lesson

What is an important idea or lesson you learned from the story?

- ◯ a. Kirk needs a new job.
- ◯ b. Banks are for ordering food and picking up groceries.
- ◯ c. Banks are helpful and keep money safe.

Copyright © 2020 n2y, LLC. All rights reserved.
Unique Learning System®, April 2020

NUMBER JOURNAL

Mary Beth is counting items at the bank. She counts 22 loan applications, 13 deposit slips and 4 money envelopes. How many items does Mary Beth count altogether?

Number of loan applications Mary Beth counts: 2 2

Number of deposit slips Mary Beth counts: 1 3

Number of money envelopes Mary Beth counts: + 4

4/20/20

How many items does Mary Beth count altogether? ___ ___

Copyright © 2020 n2y, LLC. All rights reserved.
Unique Learning System®, April 2020

NUMBER JOURNAL

Danielle is passing out items to customers at the bank.
She passes out 12 lollipops, 15 coin wrappers and 10 loan applications.
How many items does Danielle pass out altogether?

Number of lollipops Danielle passes out:

	1	2



Number of coin wrappers Danielle passes out:

	1	5

Number of loan applications Danielle passes out:

+	1	0

How many items does Danielle pass out altogether?

	___	___

4/20/20

Copyright © 2020 n2y, LLC. All rights reserved.
Unique Learning System®, April 2020

4/20/20

NUMBER JOURNAL

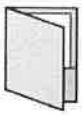

Randy is putting loan applications into folders.
There are 7 folders. He puts 6 loan applications into each folder.
How many loan applications are there altogether?

The squares represent the folders.
The Xs represent the loan applications.





7	x	6	=	___
Number of folders		Number of loan applications in each folder		Number of loan applications altogether?

Copyright © 2020 n2y, LLC. All rights reserved.
Unique Learning System®, April 2020

4/21/20



1. Review good work habits.
2. Draw a picture of yourself using good work habits.
3. Write a paragraph describing the picture.

Randy is putting items on counters at the bank. He puts 13 deposit slips, 11 money envelopes and 21 loan applications on counters. How many items does Randy put on counters altogether?

13	+	11	+	21	=	___
Number of deposit slips Randy puts on counters		Number of money envelopes Randy puts on counters		Number of loan applications Randy puts on counters		Number of items Randy puts on counters altogether?

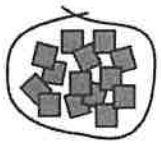

4/21/20

Copyright © 2020 n2y, LLC. All rights reserved.
Unique Learning System®, April 2020

Ryan is counting items at the bank. He counts 16 coin wrappers, 10 lollipops and 12 deposit slips. How many items does Ryan count altogether?

16	+	10	+	12	=	___
Number of coin wrappers Ryan counts		Number of lollipops Ryan counts		Number of deposit slips Ryan counts		Number of items Ryan counts altogether?



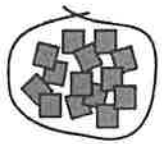

4/21/20

Copyright © 2020 n2y, LLC. All rights reserved.
Unique Learning System®, April 2020

NUMBER JOURNAL

Randy and Ryan are greeting customers at the bank.
Randy greets 100 customers. Ryan greets 156 customers.
How many customers do they greet altogether?

Randy greets
100 customers

Ryan greets
156 customers

Number of customers Randy greets:

1	0	0

Number of customers Ryan greets:

+			
	1	5	6

How many customers do they greet altogether?

___	___	___

4/31/20

Copyright © 2020 n2y, LLC. All rights reserved.
Unique Learning System®, April 2020

NUMBER JOURNAL

Danielle is counting items at the bank.
She counts 246 deposit slips and 113 money envelopes.
How many items does Danielle count altogether?

246 deposit slips

113 money envelopes

Number of deposit slips Danielle counts:

2	4	6

Number of money envelopes Danielle counts:

+	1	1	3

How many items does Danielle count altogether?

4/21/20

Copyright © 2020 n2y, LLC. All rights reserved.
Unique Learning System®, April 2020

4/22/20

1. Read
2. answer questions

Chapter 1: Mark Wants a Video Game System

Copyright © 2020 n2y, LLC. All rights reserved.
Unique Learning System®, April 2020

Mark and John are playing video games. They are playing on John's video game system. Mark wants a video game system.

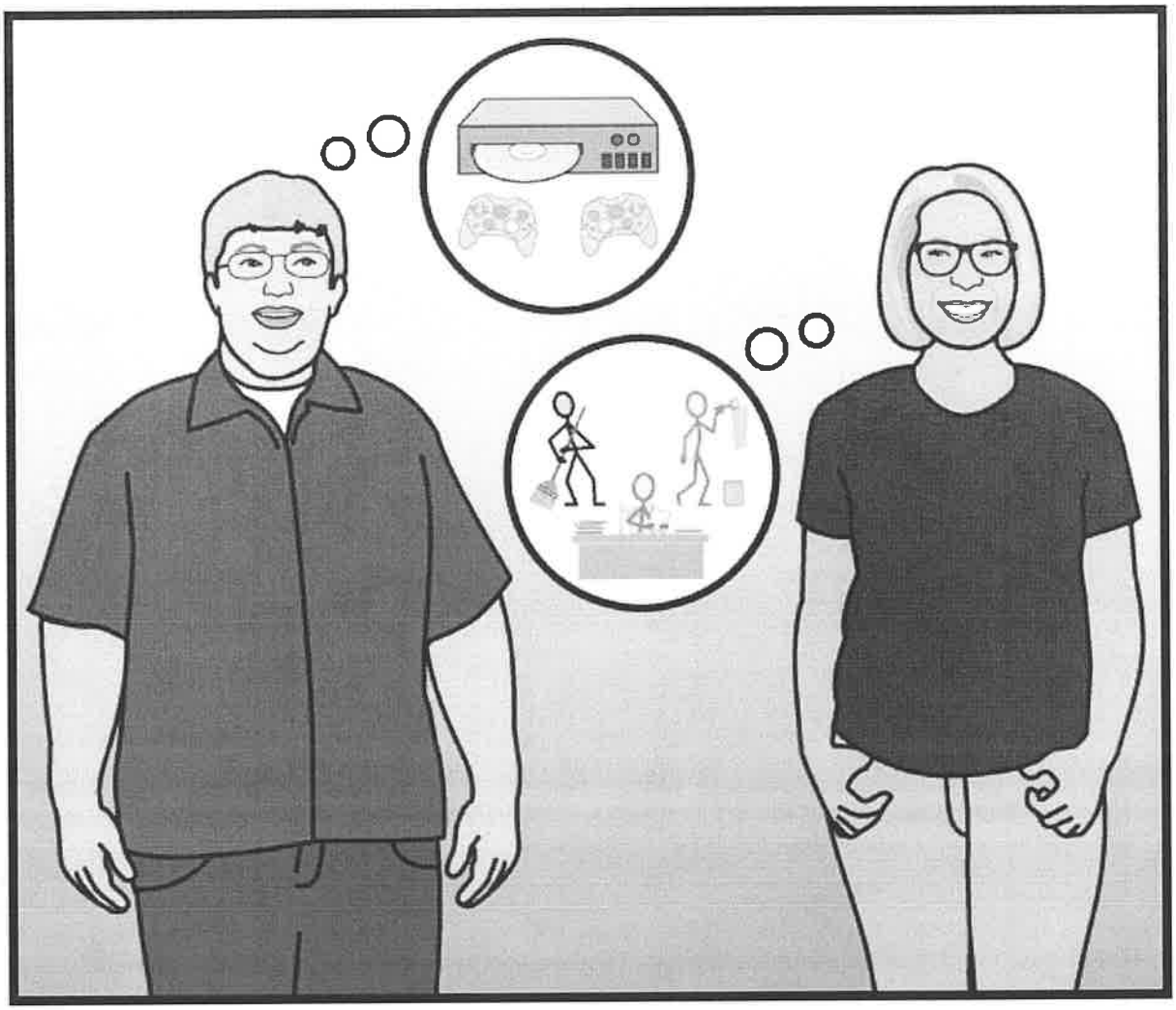

Mark talks to his mother. He asks if he can buy a video game system.

Mark's mother tells him to get a job. A job can help Mark pay for a video game system.



A job gives people money for doing work. They can buy what they want or need. Mark can earn money from a job. Then, he can buy the video game system.



Mark thinks about jobs he can get. His friend John works at the grocery store. Mark thinks about working at the grocery store.



Mark goes to the grocery store. He asks if they have a job he can do. The grocery store needs grocery baggers. What do grocery baggers do ?

Grocery baggers put groceries into bags for people. They carry the bags to people's cars. They need to be kind and help people. Mark likes this job.

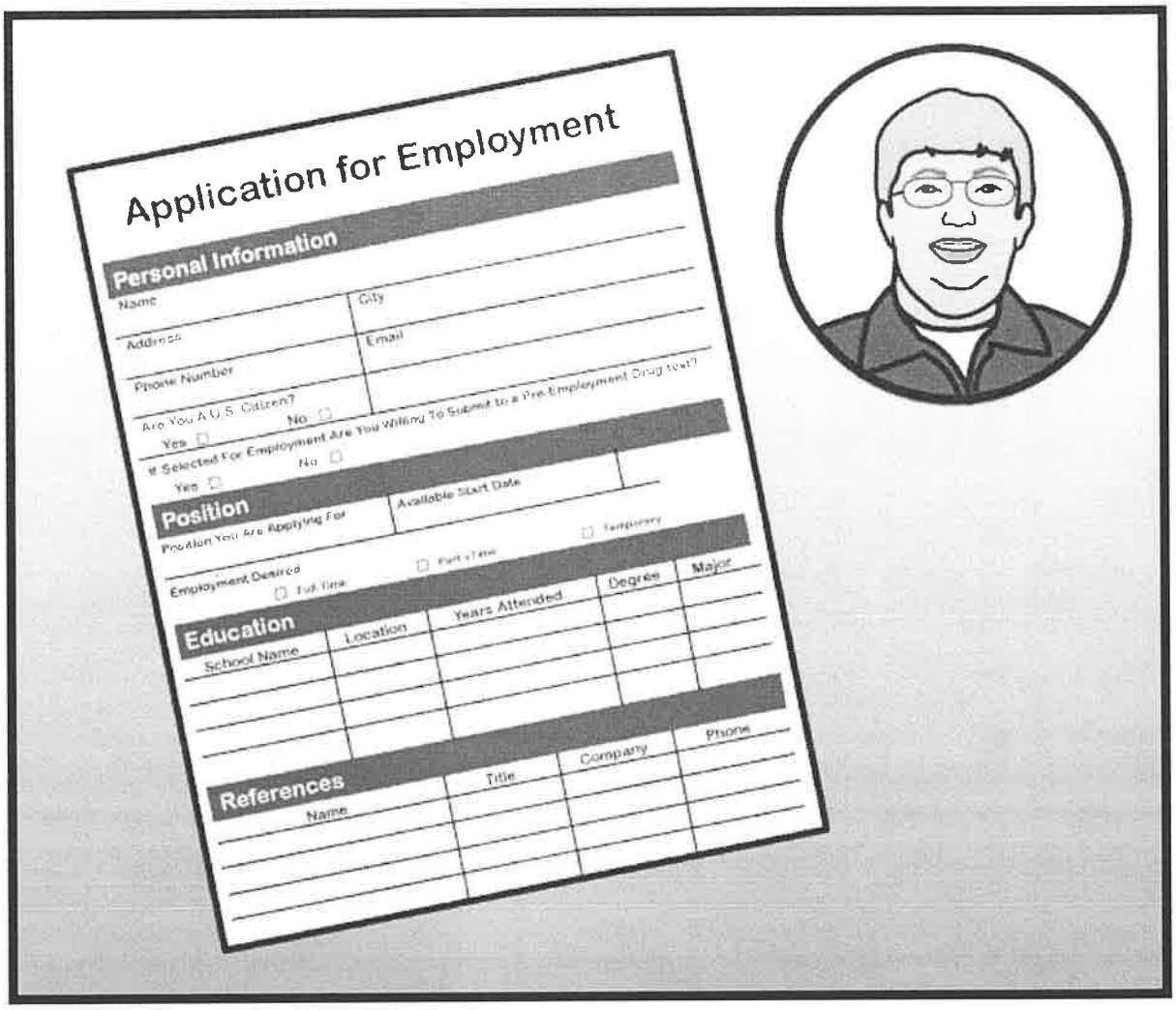

Mark gets a form to fill out for the job. He is happy he might get a job. Mark wants to earn money. Then, he can buy a video game system.

 Name: _____

1. What is this chapter about?

a. wanting a video game system

b. playing in the pool

c. going to the movies

2. What can help Mark pay for a video game system?

a. bag

b. job

c. counter

3. What does a job give people for doing work?

a. money

b. flowers

c. toys

4. Where does Mark think about working?

a. bike shop

b. movie theater

c. grocery store

5. What is important to know about this chapter?

◯ a. Mark and John eat lunch.

◯ b. Mark wants to earn money.

◯ c. Mark wants to work at the zoo.

Copyright © 2020 n2y, LLC. All rights reserved.
Unique Learning System®, April 2020

 Name: _____

Use your chapter book to help you fill in the blank.

1. **Mark loves to play _____ .**

2. **Sometimes people need to earn money to _____ things.**

3. **Money helps you buy things you _____ or need.**

4. **Mark asks the _____ if they are hiring.**

5. **The grocery store is looking for _____ .**

Copyright © 2020 n2y, LLC. All rights reserved.
Unique Learning System®, April 2020

 Name: _____

These questions may have more than one correct answer:

6. Who do grocery baggers help?

- ◯ a. referees
- ◯ b. video game players
- ◯ c. customers

7. What do grocery baggers do?

- ◯ a. bake cakes
- ◯ b. carry groceries
- ◯ c. put bags in cars

8. What does a grocery bagger need to be?

- ◯ a. helpful
- ◯ b. scary
- ◯ c. kind

9. What is a job application?

- ◯ a. form people fill out to get a job
- ◯ b. bag to put groceries in
- ◯ c. video game people play

10. Why is Mark excited?

- ◯ a. He may be able to get a job.
- ◯ b. He can start earning money to buy what he wants.
- ◯ c. He likes to make video games.

Copyright © 2020 n2y, LLC. All rights reserved.
Unique Learning System®, April 2020

Main Idea (What is this story about?)

In the beginning... 	
Then... 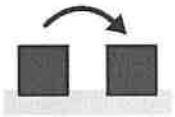	
At the end...	

What is important to know?

Copyright © 2020 n2y, LLC. All rights reserved.
Unique Learning System®, April 2020

Answer Schedule questions. 1-5 4/23/20

Time	Monday	Tuesday	Wednesday	Thursday	Friday
8:00 a.m.	Get ready	Get ready	Get ready	Get ready	Get ready
9:00 a.m.	School	School	School	School	School
10:00 a.m.					
11:00 a.m.					
12:00 p.m.					
1:00 p.m.					
2:00 p.m.					
3:00 p.m.	Homework		Homework	Play video games with John	Homework
4:00 p.m.	Work at grocery store	Homework	Work at grocery store		Work at grocery store
5:00 p.m.		Dinner		Dinner	
6:00 p.m.		Piano lesson		Homework	
7:00 p.m.		Watch favorite TV show			
8:00 p.m.	Get ready for bed	Get ready for bed	Get ready for bed	Get ready for bed	Get ready for bed

1. Mark is looking at his weekly schedule.
On Thursday, Mark will play video games with John.

What time can Mark start to play video games with John on Thursday?

a. 11:00 a.m. b. 8:00 p.m. c. 3:00 p.m.

How long can Mark play video games with John on Thursday?

a. 2 hours b. 5 hours c. 1 hour

Copyright © 2020 n2y, LLC. All rights reserved.
Unique Learning System®, April 2020

Time	Monday	Tuesday	Wednesday	Thursday	Friday
8:00 a.m.	Get ready	Get ready	Get ready	Get ready	Get ready
9:00 a.m.	School	School	School	School	School
10:00 a.m.					
11:00 a.m.					
12:00 p.m.					
1:00 p.m.					
2:00 p.m.					
3:00 p.m.	Homework		Homework	Play video games with John	Homework
4:00 p.m.	Work at grocery store	Homework	Work at grocery store		Work at grocery store
5:00 p.m.		Dinner		Dinner	
6:00 p.m.		Piano lesson		Homework	
7:00 p.m.		Watch favorite TV show			
8:00 p.m.	Get ready for bed	Get ready for bed	Get ready for bed	Get ready for bed	Get ready for bed

2. Mark is looking at his weekly schedule.
He knows he has to work at the grocery store on Monday.

What time does Mark start work at the grocery store on Monday?

a. 4:00 p.m. b. 7:00 p.m. c. 11:00 a.m.

How long will Mark work at the grocery store on Monday?

a. 30 minutes b. 4 hours c. 3 hours

Copyright © 2020 n2y, LLC. All rights reserved.
Unique Learning System®, April 2020

Time	Monday	Tuesday	Wednesday	Thursday	Friday
8:00 a.m.	Get ready	Get ready	Get ready	Get ready	Get ready
9:00 a.m.	School	School	School	School	School
10:00 a.m.					
11:00 a.m.					
12:00 p.m.					
1:00 p.m.					
2:00 p.m.					
3:00 p.m.	Homework		Homework	Play video games with John	Homework
4:00 p.m.	Work at grocery store	Homework	Work at grocery store		Work at grocery store
5:00 p.m.		Dinner		Dinner	
6:00 p.m.		Piano lesson		Homework	
7:00 p.m.		Watch favorite TV show			
8:00 p.m.	Get ready for bed	Get ready for bed	Get ready for bed	Get ready for bed	Get ready for bed

3. Mark is looking at his weekly schedule.
He wants to watch his favorite TV show on Tuesday.

What time does Mark's favorite TV show start on Tuesday?

a. 8:00 a.m. | b. 7:00 p.m. | c. 3:00 p.m.

How long does Mark's favorite TV show last on Tuesday?

a. 15 minutes | b. 1 hour | c. 6 hours

Copyright © 2020 n2y, LLC. All rights reserved.
Unique Learning System®, April 2020

Time	Monday	Tuesday	Wednesday	Thursday	Friday
8:00 a.m.	Get ready	Get ready	Get ready	Get ready	Get ready
9:00 a.m.	School	School	School	School	School
10:00 a.m.					
11:00 a.m.					
12:00 p.m.					
1:00 p.m.					
2:00 p.m.					
3:00 p.m.	Homework		Homework	Play video games with John	Homework
4:00 p.m.	Work at grocery store	Homework	Work at grocery store		Work at grocery store
5:00 p.m.		Dinner		Dinner	
6:00 p.m.		Piano lesson		Homework	
7:00 p.m.		Watch favorite TV show			
8:00 p.m.	Get ready for bed	Get ready for bed	Get ready for bed	Get ready for bed	Get ready for bed

4. Mark is looking at his weekly schedule. He knows he has to go to school every day.

What time does Mark get out of school every day?

a. 5:00 p.m. b. 8:00 a.m. c. 3:00 p.m.

How long is Mark at school every day?

a. 6 hours b. 7 hours c. 2 hours

Copyright © 2020 n2y, LLC. All rights reserved.
Unique Learning System®, April 2020

Time	Monday	Tuesday	Wednesday	Thursday	Friday
8:00 a.m.	Get ready	Get ready	Get ready	Get ready	Get ready
9:00 a.m.	School	School	School	School	School
10:00 a.m.					
11:00 a.m.					
12:00 p.m.					
1:00 p.m.					
2:00 p.m.					
3:00 p.m.	Homework		Homework	Play video games with John	Homework
4:00 p.m.	Work at grocery store	Homework	Work at grocery store		Work at grocery store
5:00 p.m.		Dinner		Dinner	
6:00 p.m.		Piano lesson		Homework	
7:00 p.m.		Watch favorite TV show			
8:00 p.m.	Get ready for bed	Get ready for bed	Get ready for bed	Get ready for bed	Get ready for bed

5. Mark is looking at his weekly schedule. He knows he has piano lessons on Tuesday.

What time is Mark's piano lesson on Tuesday?

a. 12:00 p.m. b. 6:00 p.m. c. 10:00 a.m.

How long is Mark's piano lesson on Tuesday?

a. 3 hours b. 45 minutes c. 1 hour

Copyright © 2020 n2y, LLC. All rights reserved.
Unique Learning System®, April 2020

NUMBER JOURNAL

Randy is sorting items into piles at the bank for the bank tellers.
He sorts 68 money envelopes and 21 loan applications.
How many items does Randy sort into piles altogether?

68 money envelopes

21 loan applications

Number of money envelopes Randy sorts into piles: 6 8

Number of loan applications Randy sorts into piles: + 2 1

How many items does Randy sort into piles altogether? ___ ___

4/23/20

Copyright © 2020 n2y, LLC. All rights reserved.
Unique Learning System®, April 2020

Math Story 7b
Adding to 100 Vertical

NUMBER JOURNAL

Mrs. B's class is counting items at the bank.
They count 41 coin wrappers and 35 deposit slips.
How many items do they count altogether?

41 coin wrappers

35 deposit slips

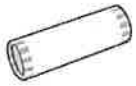 Number of coin wrappers they count: 4 1

Number of deposit slips they count: + 3 5

How many items do they count altogether? ___ ___

4/23/20

Copyright © 2020 n2y, LLC. All rights reserved.
Unique Learning System®, April 2020

9

NUMBER JOURNAL

Randy is sorting items into piles at the bank for the bank tellers.
He sorts 55 money envelopes and 33 loan applications.
How many items does Randy sort into piles altogether?

55 money envelopes

33 loan applications

Number of money envelopes Randy sorts into piles: **5 5**

Number of loan applications Randy sorts into piles: **+ 3 3**

How many items does Randy sort into piles altogether?

4/23/20

Copyright © 2020 n2y, LLC. All rights reserved.
Unique Learning System®, April 2020

Randy is unpacking items from a box at the bank.
He unpacks 45 lollipops. He unpacks 53 money envelopes.
How many items does Randy unpack from a box altogether?

45 lollipops

53 money envelopes

4	5

Number of lollipops Randy unpacks

+

5	3

Number of money envelopes Randy unpacks

=

___	___

Number of items Randy unpacks from a box altogether?

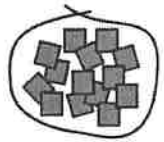

4/23/20

Copyright © 2020 n2y, LLC. All rights reserved.
Unique Learning System®, April 2020

NUMBER JOURNAL

Danielle is counting coin wrappers at the bank.
She has 462 coin wrappers. She counts 178 coin wrappers.
How many coin wrappers are left to count?

has 462 coin wrappers

1 2 3 counts 178 coin wrappers

Number of coin wrappers Danielle has:

4	6	2

1 2 3 Number of coin wrappers Danielle counts: −

1	7	8

How many coin wrappers are left to count?

4/23/20

Copyright © 2020 n2y, LLC. All rights reserved.
Unique Learning System®, April 2020

NUMBER JOURNAL

Ryan and Randy are sorting deposit slips into piles at the bank.
Ryan sorts 284 deposit slips. Randy sorts 136 deposit slips.
How many more deposit slips does Ryan sort into piles than Randy?

284 deposit slips

136 deposit slips

Number of deposit slips Ryan sorts:

2	8	4

Number of deposit slips Randy sorts:

-	1	3	6

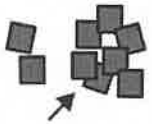

How many more deposit slips does Ryan sort into piles than Randy?

4/23/20

Copyright © 2020 n2y, LLC. All rights reserved.
Unique Learning System®, April 2020

9

NUMBER JOURNAL

Danielle is counting coin wrappers at the bank.
She has 229 coin wrappers. She counts 149 coin wrappers.
How many coin wrappers are left to count?

has 229 coin wrappers

1 2 3 counts 149 coin wrappers

Number of coin wrappers Danielle has:

	2	9

1 2 3 Number of coin wrappers Danielle counts:

-	1	4	9

How many coin wrappers are left to count?

4|23|20

Copyright © 2020 n2y, LLC, All rights reserved.
Unique Learning System®, April 2020

4/23/20

NUMBER JOURNAL

Brent is placing an equal number of lollipops into jars.
There are 32 lollipops altogether. There are 4 jars.
How many lollipops does Brent place in each jar?

The circles represent the jars.
The Xs represent the lollipops.

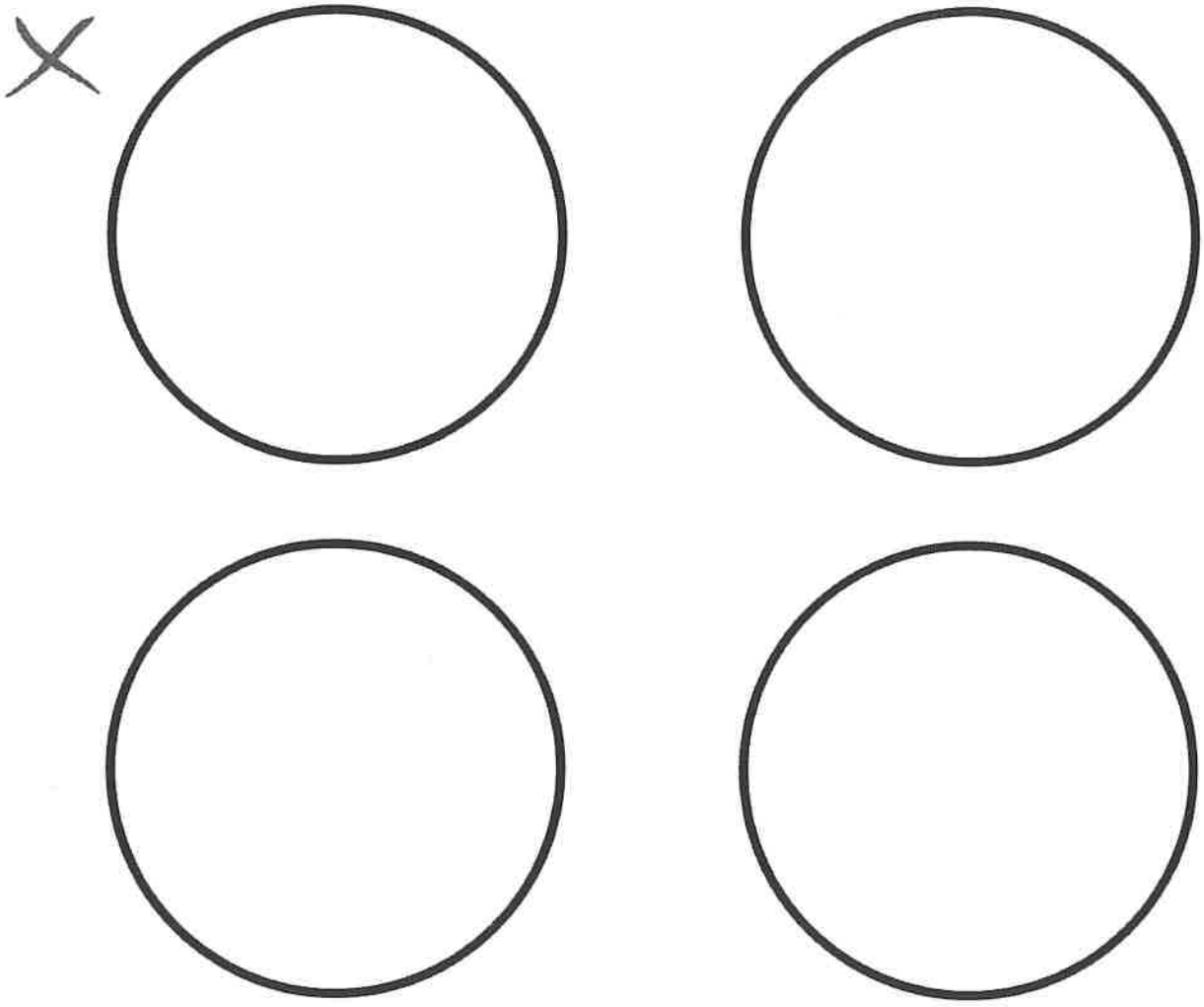

32	÷	4	=	
Number of lollipops altogether		Number of jars		Number of lollipops in each jar?

Copyright © 2020 n2y, LLC. All rights reserved.
Unique Learning System®, April 2020

4/23/20

NUMBER JOURNAL

Mary Beth is putting an equal number of deposit slips in rows on a counter. There are 56 deposit slips altogether. There are 8 rows. How many deposit slips does Mary Beth put in each row?



The squares represent the rows.
The Xs represent the deposit slips.





56	÷	8	=	___
Number of deposit slips altogether		Number of rows		Number of deposit slips in each row?

Copyright © 2020 n2y, LLC. All rights reserved.
Unique Learning System®, April 2020

4/24/20

You get $10.00 for pet sitting.
You want to buy art supplies that cost $10.00.
What should you do?

save your money

buy the art supplies

You want to buy a video game. You just got your paycheck, but it's not enough money to buy the video game. What should you do?

spend your paycheck on other things

put your paycheck in the bank

You need a hat.
You find a green hat for $6.50 and a red hat for $11.00.
Which hat should you buy?

green hat

red hat

You want a new bike.
You've been doing chores to earn extra money.
What should you do to get a bike?

save your money until you have enough

take someone else's bike

Copyright © 2020 n2y, LLC. All rights reserved.
Unique Learning System®, April 2020

4/24/20

You are saving money to buy a cell phone. You see an ice cream truck at the park. You want to get a treat. What should you do?

save your money

buy an ice cream

You need a new backpack.
The green one costs $15.00. The black one costs $12.00.
Which one should you buy?

green backpack

black backpack

You are saving for a new computer.
You see a T-shirt at the mall that you want to buy.
What should you do?

buy the T-shirt

save your money

You get your paycheck. You want to spend money on movie tickets. You also want to save money to buy a new TV.
What should you do with your paycheck.

spend it all on movie tickets

put some money in your savings account

Copyright © 2020 n2y, LLC. All rights reserved.
Unique Learning System®, April 2020

Mrs. B's class is stacking items into piles at the bank.
They stack 80 deposit slips and 10 loan applications.
How many items does the class stack into piles altogether?

80 deposit slips

10 loan applications

8	0

Number of deposit slips Mrs. B's class stacks

+

1	0

Number of loan applications Mrs. B's class stacks

=

Number of items Mrs. B's class stacks into piles altogether?

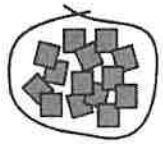

4/24/20

Copyright © 2020 n2y, LLC. All rights reserved.
Unique Learning System®, April 2020

NUMBER JOURNAL

Danielle is collecting items from bank tellers at the bank.
She collects 42 coin wrappers and 28 money envelopes.
How many items does Danielle collect altogether?

42 coin wrappers

28 money envelopes

Number of coin wrappers Danielle collects:

Number of money envelopes Danielle collects:

$$\begin{array}{r} 42 \\ +\ 28 \\ \hline \end{array}$$

How many items does Danielle collect altogether?

__ __

4 | 24 | 20

Copyright © 2020 n2y, LLC. All rights reserved.
Unique Learning System®, April 2020

NUMBER JOURNAL

Ryan is sorting items into piles at the bank.
He sorts 53 loan applications and 39 deposit slips.
How many items does Ryan sort into piles altogether?

53 loan applications

39 deposit slips

Number of loan applications Ryan sorts into piles:

−	5	3

Number of deposit slips Ryan sorts into piles:

+	3	9

How many items does Ryan sort into piles altogether?

	___	___

4/24/20

Copyright © 2020 n2y, LLC. All rights reserved,
Unique Learning System®, April 2020

NUMBER JOURNAL

Mary Beth is passing out items to customers at the bank.
She passes out 57 lollipops and 25 money envelopes.
How many items does Mary Beth pass out altogether?

57 lollipops

25 money envelopes

Number of lollipops Mary Beth passes out:

	5	7

Number of money envelopes Mary Beth passes out:

+	2	5

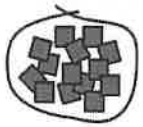 How many items does Mary Beth pass out altogether?

	___	___

4/24/20

Copyright © 2020 n2y, LLC, All rights reserved.
Unique Learning System®, April 2020

Math Story 2a
Multiplication

NUMBER JOURNAL

Randy is putting loan applications into folders.
There are 7 folders. He puts 6 loan applications into each folder.
How many loan applications are there altogether?

7 folders

6 loan applications

Number of folders: 7

Number of loan applications he puts in each folder: x 6

How many loan applications are there altogether?

4/24/20

Copyright © 2020 n2y, LLC. All rights reserved.
Unique Learning System®, April 2020

NUMBER JOURNAL

Mary Beth is placing deposit slips on tables in the bank.
There are 4 tables. She puts 5 deposit slips on each table.
How many deposit slips are there altogether?

4 tables

5 deposit slips

Number of tables: **4**

Number of deposit slips on each table: **x 5**

How many deposit slips are there altogether? ____

4 | 24 | 20

Copyright © 2020 n2y, LLC. All rights reserved.
Unique Learning System®, April 2020

4/24/20

NUMBER JOURNAL

Mary Beth is placing deposit slips on tables in the bank. There are 4 tables. She puts 5 deposit slips on each table. How many deposit slips are there altogether?

The squares represent the tables.
The Xs represent the deposit slips.



4	x	5	=	____
Number of tables		Number of deposit slips on each table		Number of deposit slips altogether?

Copyright © 2020 n2y, LLC. All rights reserved.
Unique Learning System®, April 2020

NUMBER JOURNAL

Ryan is putting lollipops into jars at the bank.
There are 10 jars. He puts 15 lollipops in each jar.
How many lollipops are there altogether?

10 jars

15 lollipops

Number of jars: **10**

Number of lollipops in each jar: **x 15**

How many lollipops are there altogether?

4/24/26

Copyright © 2020 n2y, LLC. All rights reserved.
Unique Learning System®, April 2020

Math Story 4b
Multiplication - Double Digit

NUMBER JOURNAL

Mary Beth is sorting deposit slips into piles.
There are 16 piles. She puts 19 deposit slips into each pile.
How many deposit slips are there altogether?

16 piles

19 deposit slips

Number of piles: **16**

Number of deposit slips in each pile: **x 19**

How many deposit slips are there altogether?

4/24/20

Copyright © 2020 n2y, LLC. All rights reserved.
Unique Learning System®, April 2020

NUMBER JOURNAL

Ryan is putting lollipops into jars at the bank.
There are 79 jars. He puts 60 lollipops in each jar.
How many lollipops are there altogether?

79 jars

60 lollipops

Number of jars: **79**

Number of lollipops in each jar: **x 60**

How many lollipops are there altogether?

4/24/20

Copyright © 2020 n2y, LLC. All rights reserved.
Unique Learning System®, April 2020

4/24/20

NUMBER JOURNAL

Danielle is putting an equal number of coin wrappers into boxes.
There are 12 coin wrappers altogether. There are 2 boxes.
How many coin wrappers does Danielle put into each box?

The squares represent the boxes.
The Xs represent the coin wrappers.



12	÷	2	=	___
Number of coin wrappers altogether		Number of boxes		Number of coin wrappers in each box?

Copyright © 2020 n2y, LLC. All rights reserved.
Unique Learning System®, April 2020

4/27/20

1. Read

Chapter 2:

2. Answer questions

Mark Gets Hired

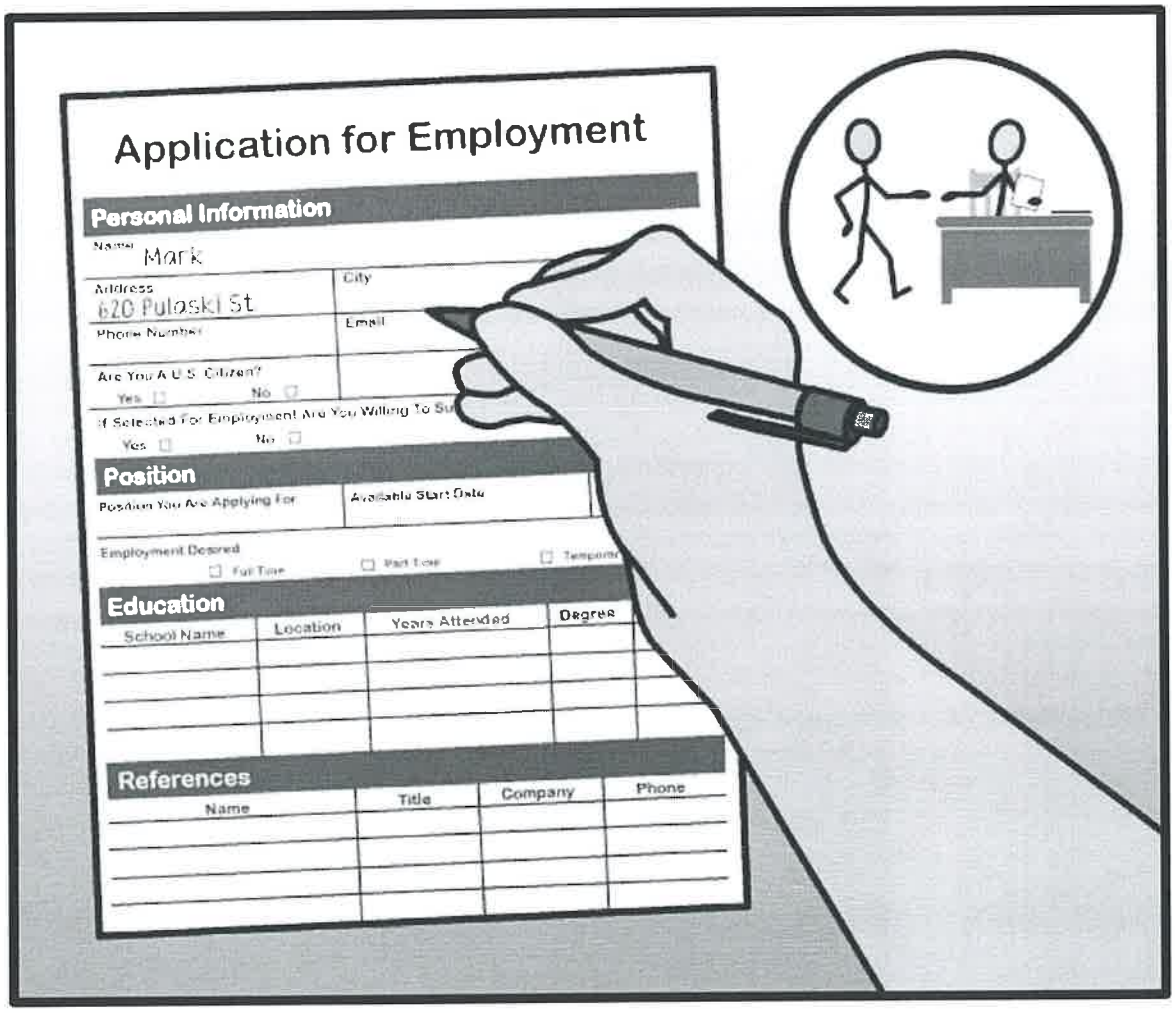

Copyright © 2020 n2y, LLC. All rights reserved.
Unique Learning System®, April 2020

People need to fill out forms to get jobs. Businesses look at the forms. They pick the best person for the job. The person is hired to do the job. Mark will fill out a form to get a job.

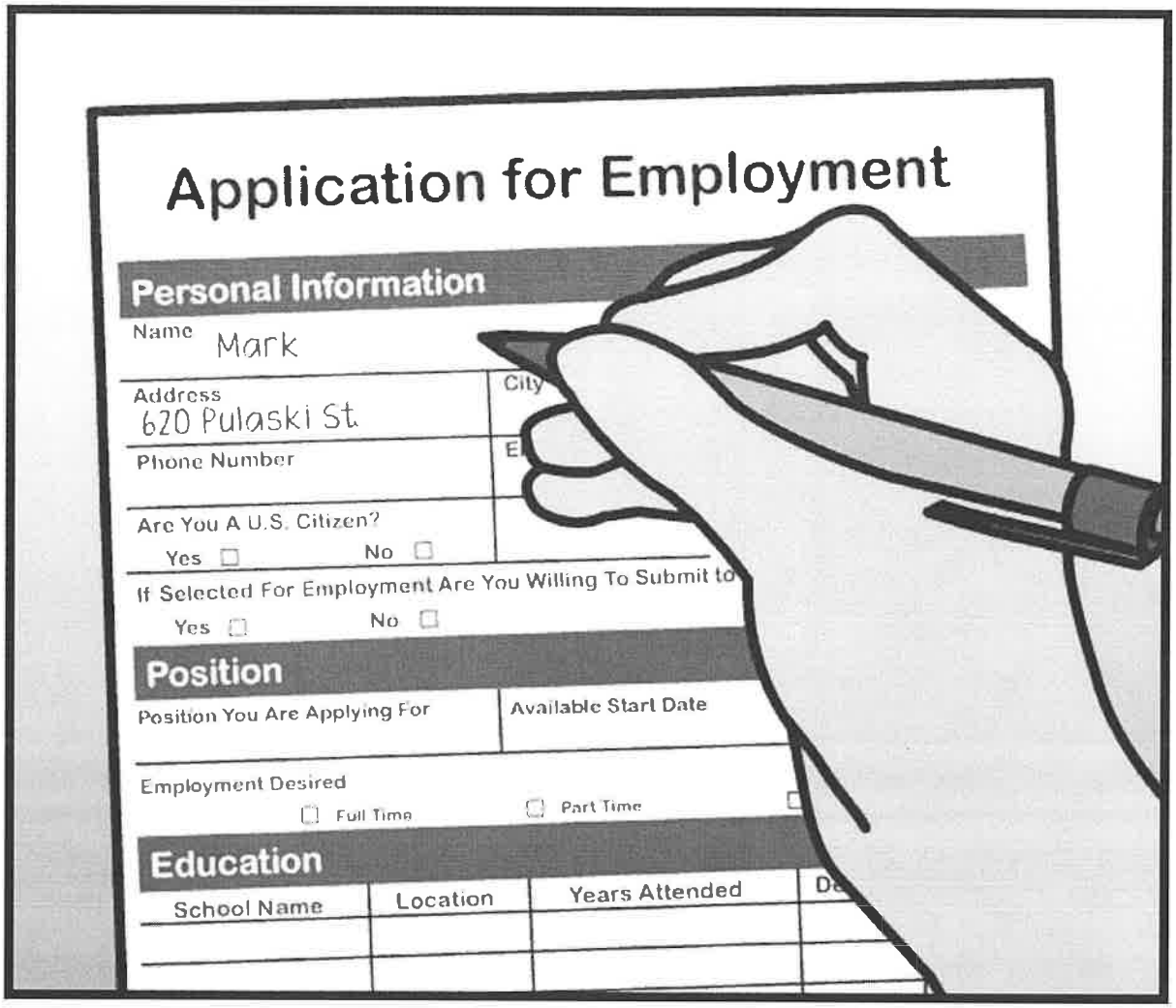

Mark writes his name and birthdate. He writes his address and phone number. He doesn't write down any jobs he has had. This will be Mark's first job.

A grocery bagger needs to be helpful and kind. Mark writes about how he is helpful and kind. He helps his mother carry groceries. He opens doors for people.



Mark gives the form to the store manager. The store manager talks to him. She asks him questions. Then, Mark gets the job !



Mark will work three days a week.

He will earn money while he works.

Mark can spend his money on things he wants. He can spend his money on things he needs.



Mark wants to be good at his job. Mark needs to follow his schedule. He needs to be on time. He writes down his schedule at home.



Mark is happy he got hired for the job. Now, he can earn money. He can spend the money on a video game system. Mark is ready to start his first job.

Name: _____

1. What is this chapter about?

a. flying a kite

b. getting hired for a job

c. shopping at a store

2. Who does Mark give his form to?

a. mother

b. teacher

c. manager

3. What will Mark do three days a week?

a. work

b. talk on the phone

c. sing

4. What does Mark need to follow?

a. menu

b. TV show

c. schedule

5. What is important to know about this chapter?

◯ a. Mark works at the pet store.

◯ b. Mark is happy he got hired for the job.

◯ c. Mark does not like carrying groceries.

Copyright © 2020 n2y, LLC. All rights reserved.
Unique Learning System®, April 2020

Name: _____

Use your chapter book to help you fill in the blank.

1. **Mark looks at the _____ from the grocery store.**

2. **Working as a grocery bagger is a great first _____ .**

3. **Mark knows a grocery bagger needs to be _____ and kind.**

4. **Mark helps his mother carry _____ from her car and put them away.**

5. **The store manager asks Mark _____ .**

Copyright © 2020 n2y, LLC. All rights reserved.
Unique Learning System®, April 2020

Name: _____

These questions may have more than one correct answer:

6. What does the store manager talk to Mark about?

- ◯ a. work schedule
- ◯ b. book report
- ◯ c. homework

7. What will Mark get every two weeks when he works?

- ◯ a. job applications
- ◯ b. movie tickets
- ◯ c. money

8. Where does Mark write down his schedule?

- ◯ a. textbook
- ◯ b. calendar
- ◯ c. homework folder

9. Why is Mark happy?

- ◯ a. He got his first job.
- ◯ b. He can earn money.
- ◯ c. He can spend his money on a video game system.

10. What does Mark need to do for his job?

- ◯ a. He needs to throw away groceries.
- ◯ b. He needs to be on time.
- ◯ c. He needs to help customers and be kind.

Copyright © 2020 n2y, LLC. All rights reserved.
Unique Learning System®, April 2020

Main Idea (What is this story about?)

In the beginning...	
Then... 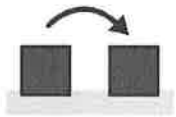	
At the end...	

What is important to know?

Copyright © 2020 n2y, LLC. All rights reserved.
Unique Learning System®, April 2020

NUMBER JOURNAL

Brent is stacking items on counters at the bank.
He stacks 19 deposit slips and 23 loan applications.
How many items does Brent stack on counters altogether?

19 deposit slips

23 loan applications

Number of deposit slips Brent stacks:

	1	9

Number of loan applications Brent stacks:

+	2	3

How many items does Brent stack on counters altogether?

4/28/20

Copyright © 2020 n2y, LLC, All rights reserved.
Unique Learning System®, April 2020

9

NUMBER JOURNAL

Brent is stacking items on counters at the bank.
He stacks 62 deposit slips and 19 loan applications.
How many items does Brent stack on counters altogether?

62 deposit slips

19 loan applications

Number of deposit slips Brent stacks:

−	6	2

Number of loan applications Brent stacks:

+	1	9

How many items does Brent stack on counters altogether?

4|28|20

Copyright © 2020 n2y, LLC. All rights reserved.
Unique Learning System®, April 2020

NUMBER JOURNAL

Danielle is sorting items into piles at the bank.
She sorts 49 coin wrappers and 34 money envelopes.
How many items does Danielle sort into piles altogether?

49 coin wrappers

34 money envelopes

Number of coin wrappers Danielle sorts into piles:

	4	9

Number of money envelopes Danielle sorts into piles:

+	3	4

How many items does Danielle sort into piles altogether?

	___	___

4/28/20

Copyright © 2020 n2y, LLC. All rights reserved.
Unique Learning System®, April 2020

NUMBER JOURNAL

Mary Beth is passing out items to customers at the bank.
She passes out 75 lollipops and 19 loan applications.
How many items does Mary Beth pass out altogether?

75 lollipops

19 loan applications

Number of lollipops Mary Beth passes out:

	7	5

Number of loan applications Mary Beth passes out: +

	1	9

4/28/20

How many items does Mary Beth pass out altogether?

___	___

Copyright © 2020 n2y, LLC. All rights reserved.
Unique Learning System®, April 2020

9

NUMBER JOURNAL

Mary Beth is passing out items to customers at the bank.
She passes out 51 lollipops and 33 loan applications.
How many items does Mary Beth pass out altogether?

51 lollipops

33 loan applications

Number of lollipops Mary Beth passes out: 5 1

Number of loan applications Mary Beth passes out: + 3 3

How many items does Mary Beth pass out altogether?

4/28/20

Copyright © 2020 n2y, LLC. All rights reserved.
Unique Learning System®, April 2020

9

NUMBER JOURNAL

Ryan and Randy are stacking money envelopes at the bank.
Ryan stacks 50 money envelopes. Randy stacks 23 money envelopes.
How many more money envelopes does Ryan stack than Randy?

50 money envelopes

23 money envelopes

Number of money envelopes Ryan stacks:

−	5	0

Number of money envelopes Randy stacks:

-	2	3

How many more money envelopes does Ryan stack than Randy?

41 28 20

Copyright © 2020 n2y, LLC. All rights reserved.
Unique Learning System®, April 2020

4/29/20

1. Read

2. answer questions

Chapter 3:
Mark Goes to the Bank



Copyright © 2020 n2y, LLC. All rights reserved.
Unique Learning System®, April 2020



Mark works hard at his job. He gets his first paycheck. The grocery store gives Mark a check. A check is a way to pay people. They get a check instead of cash.

What will Mark do with the money he earned ? Will he spend it or save it ? Mark wants to go to the bank. A bank can keep Mark's money safe.

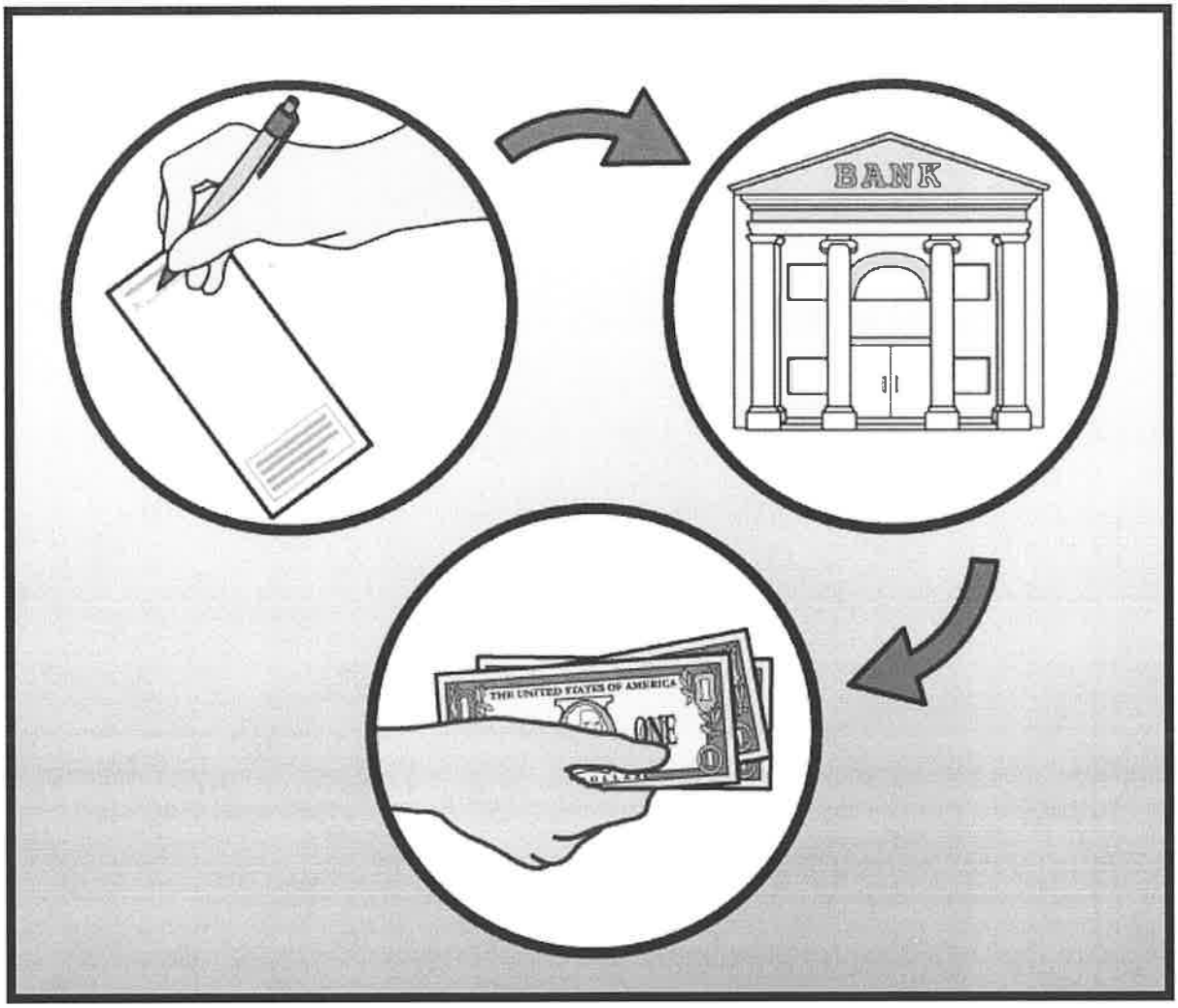

Mark can do different things at the bank. Mark can cash his check at the bank. He can sign his check and give it to the bank. Then, the bank will give him cash to spend.



Mark can put money into a checking account. The bank will keep his money safe. Mark can spend his money when he wants. The bank helps Mark know how much he spends.

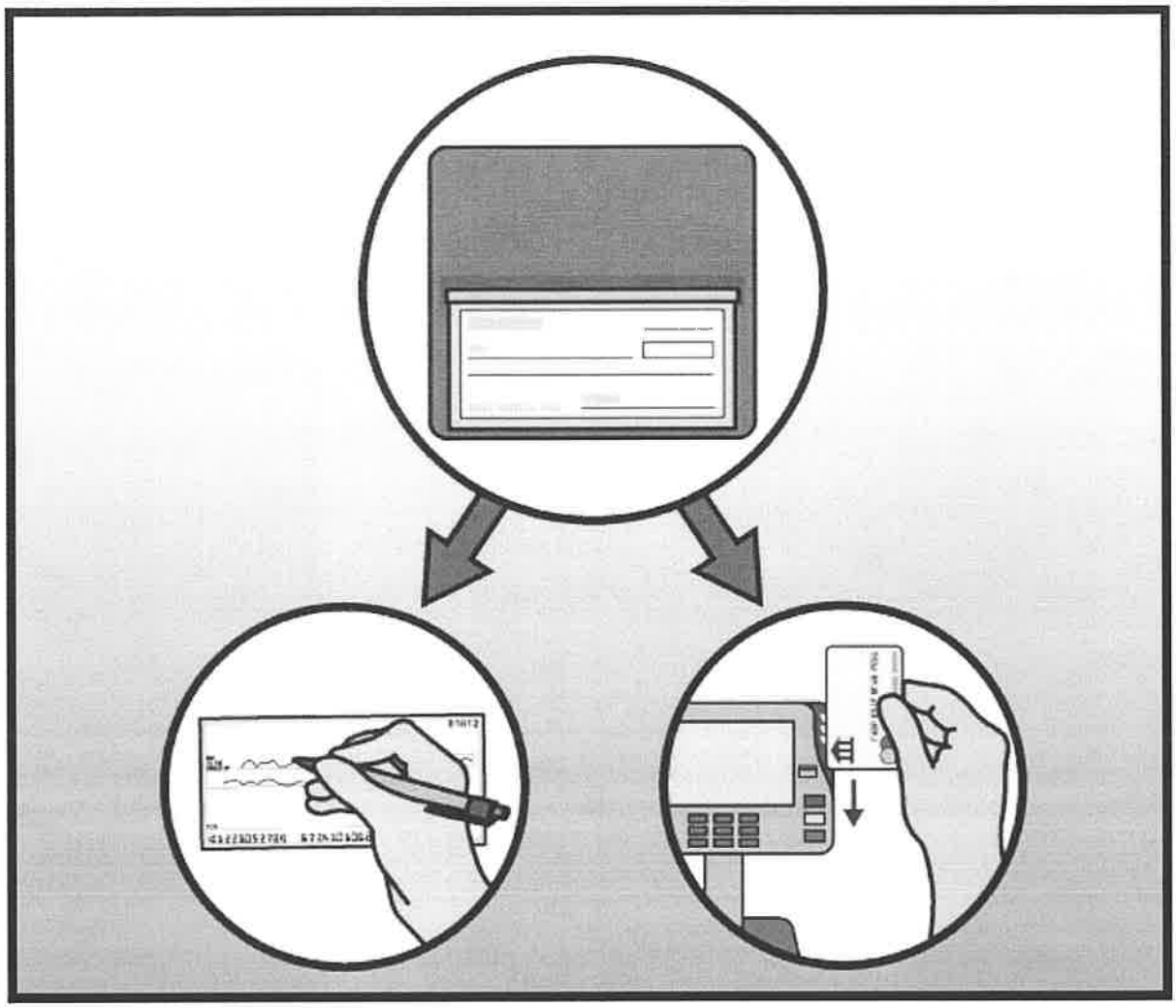

The bank will give Mark checks and a debit card. Mark can buy things at a store. Mark can use a check or debit card to pay. The bank will take money out of his checking account.



Mark can put money into a savings account. People save money to buy big things. They save money to buy houses and cars. The bank pays people to keep money in a savings account. Mark can earn more money by having a savings account.

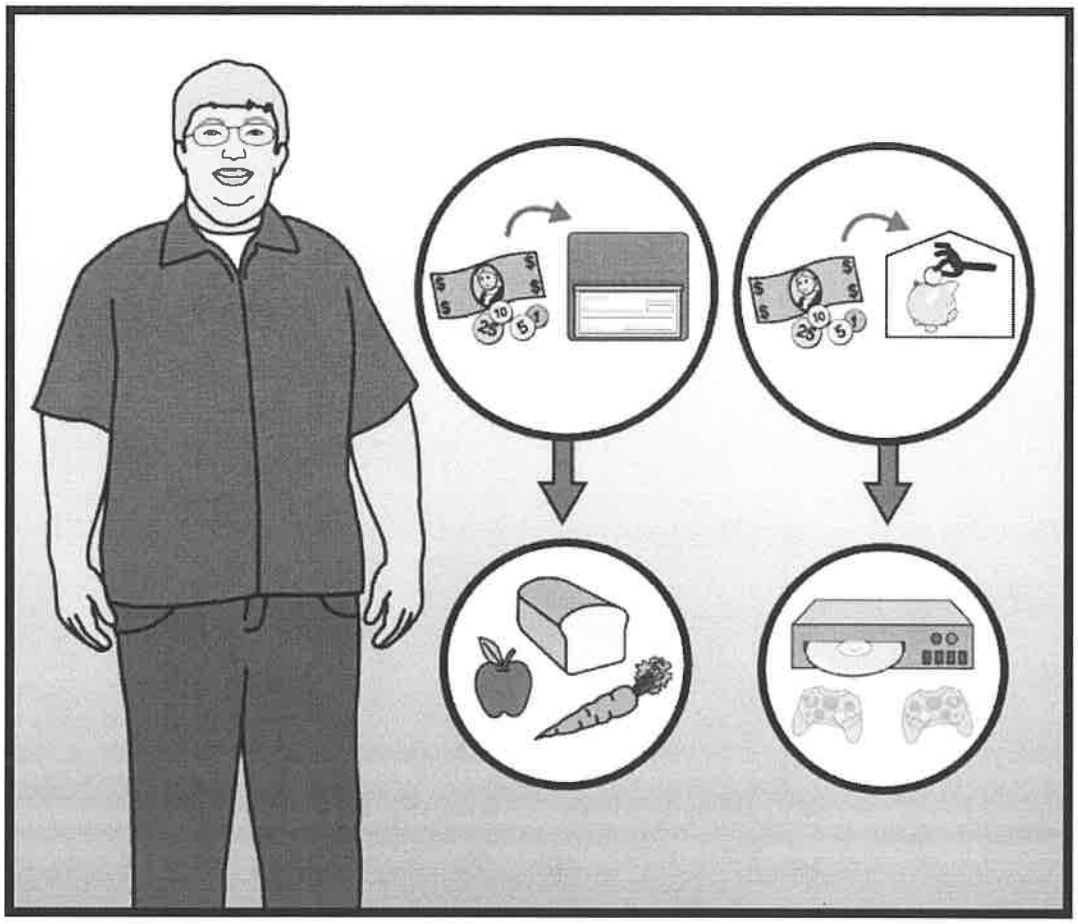

Mark will put some money into a checking account. He can spend his money on things he wants. Mark will put some money into a savings account. He can save money to buy a video game system.



Mark signs his check. He puts his money into bank accounts. Mark can keep his money safe at the bank. Now, Mark can spend and save his money.

Name: _____

Use your chapter book to help you fill in the blank.

1. **After two weeks, Mark _____ his first paycheck.**

2. **Mark wants to keep his _____ in a safe place.**

3. **The _____ explains that Mark can do different things with his money.**

4. **Mark can give his check to the bank to get _____ right away.**

5. **Mark can also put his money in a _____ .**

Copyright © 2020 n2y, LLC. All rights reserved.
Unique Learning System®, April 2020

Name: _____

These questions may have more than one correct answer:

6. What can Mark use his money in his checking account to buy?

- ◯ a. homework
- ◯ b. magazines
- ◯ c. snacks

7. What can Mark use to pay for things with money from his checking account?

- ◯ a. check
- ◯ b. book
- ◯ c. debit card

8. What do people save money in savings accounts for?

- ◯ a. emergencies
- ◯ b. cars
- ◯ c. houses

9. What does Mark do to put his money in the bank?

- ◯ a. fills out deposit slips
- ◯ b. mails it in an envelope
- ◯ c. signs the back of his check

10. Why is Mark glad?

- ◯ a. He can spend his money.
- ◯ b. His money will be safe at the bank.
- ◯ c. He can save his money.

Copyright © 2020 n2y, LLC. All rights reserved.
Unique Learning System®, April 2020

Main Idea (What is this story about?)

In the beginning...	
Then... 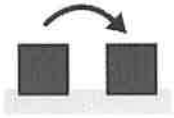	
At the end...	

What is important to know?

Copyright © 2020 n2y, LLC. All rights reserved.
Unique Learning System®, April 2020

NUMBER JOURNAL

Mary Beth is counting items behind the counter at the bank.
She counts 411 deposit slips. She counts 299 loan applications.
How many more deposit slips does Mary Beth count than loan applications?

411 deposit slips

299 loan applications

Number of deposit slips Mary Beth counts:

4	1	1

Number of loan applications Mary Beth counts:

-	2	9	9

4/30/20

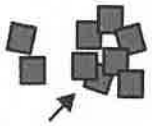 How many more deposit slips does Mary Beth count than loan applications?

Copyright © 2020 n2y, LLC. All rights reserved.
Unique Learning System®, April 2020

NUMBER JOURNAL

Ryan and Randy are passing out lollipops to customers at the bank. Ryan passes out 356 lollipops. Randy passes out 328 lollipops. How many more lollipops does Ryan pass out than Randy?

356 lollipops

328 lollipops

Number of lollipops Ryan passes out:

	3	5	6

Number of lollipops Randy passes out:

-	3	2	8

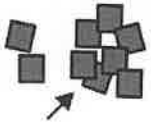

How many more lollipops does Ryan pass out than Randy?

4/30/20

Copyright © 2020 n2y, LLC. All rights reserved.
Unique Learning System®, April 2020

4/30/20

NUMBER JOURNAL

Brent is counting customers in line at the bank.
There are 2 lines. There are 6 customers in each line.
How many customers are there altogether?

The squares represent the lines.
The Xs represent the number of customers.



2	x	6	=	____
Number of lines		Number of customers in each line		Number of customers altogether?

Copyright © 2020 n2y, LLC. All rights reserved.
Unique Learning System®, April 2020

NUMBER JOURNAL

Danielle is putting coin wrappers in stacks at the bank.
There are 3 stacks. She puts 9 coin wrappers in each stack.
How many coin wrappers are there altogether?

3 stacks

9 coin wrappers

Number of stacks: 3

Number of coin wrappers in each stack: x 9

How many coin wrappers are there altogether?

4/30/20

Copyright © 2020 n2y, LLC. All rights reserved.
Unique Learning System®, April 2020

4/30/20

NUMBER JOURNAL

Danielle is putting coin wrappers in stacks at the bank.
There are 3 stacks. She puts 9 coin wrappers in each stack.
How many coin wrappers are there altogether?

The squares represent the stacks.
The Xs represent the coin wrappers.

X

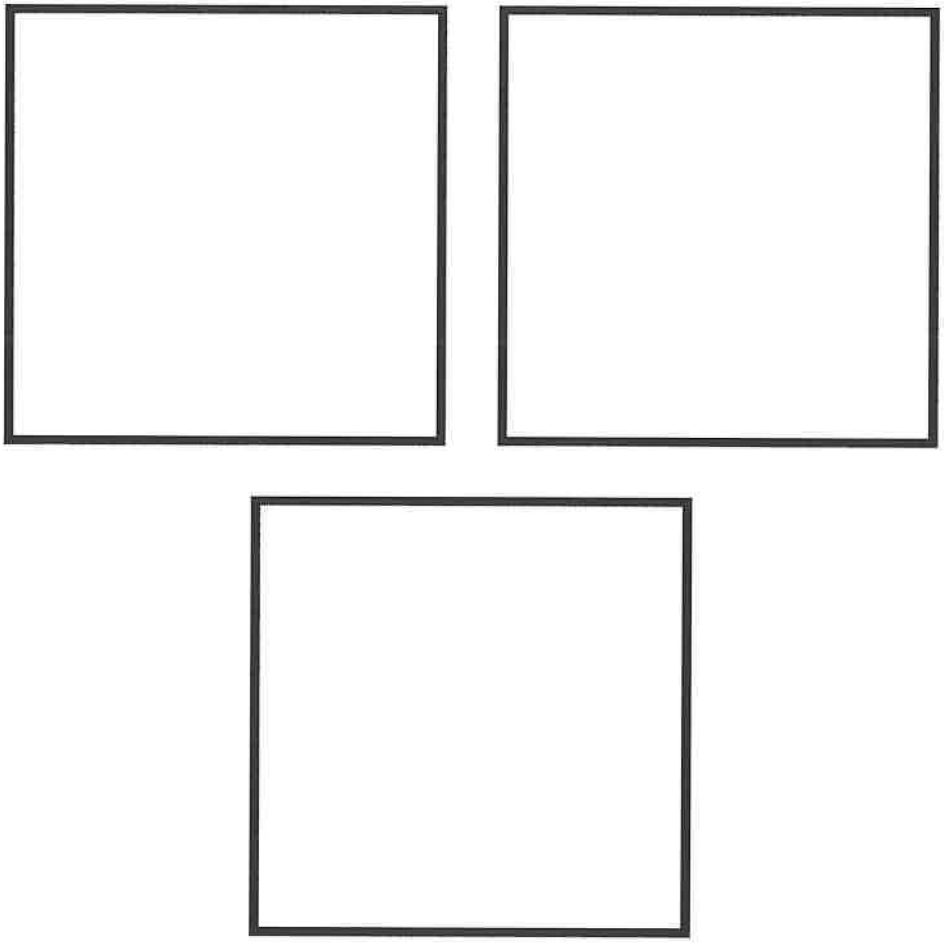

3	x	9	=	___
Number of stacks		Number of coin wrappers in each stack		Number of coin wrappers altogether?

Copyright © 2020 n2y, LLC. All rights reserved.
Unique Learning System®, April 2020

NUMBER JOURNAL

Mrs. B's class is handing out items at the bank.
They hand out 132 coin wrappers and 91 lollipops.
How many items do they hand out altogether?

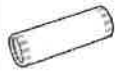 132 coin wrappers

91 lollipops

Number of coin wrappers the class hands out:

1	3	2

Number of lollipops the class hands out: +

	9	1

How many items do they hand out altogether?

4/30/20

Copyright © 2020 n2y, LLC. All rights reserved.
Unique Learning System®, April 2020

NUMBER JOURNAL

Brent is stacking items on counters at the bank.
He stacks 119 deposit slips and 190 loan applications.
How many items does Brent stack on counters altogether?

119 deposit slips

190 loan applications

Number of deposit slips Brent stacks:

1	1	9

Number of loan applications Brent stacks: +

1	9	0

How many items does Brent stack on counters altogether?

4/30/20

Copyright © 2020 n2y, LLC. All rights reserved.
Unique Learning System®, April 2020

9

NUMBER JOURNAL

Brent is stacking items on counters at the bank.
He stacks 162 deposit slips and 131 loan applications.
How many items does Brent stack on counters altogether?

162 deposit slips

131 loan applications

Number of deposit slips Brent stacks: 1 6 2

Number of loan applications Brent stacks: + 1 3 1

How many items does Brent stack on counters altogether?

5 | 1 | 20

Copyright © 2020 n2y, LLC. All rights reserved.
Unique Learning System®, April 2020

NUMBER JOURNAL

Ryan needs to help 30 customers.
There are 30 customers. He helps 27 customers.
How many more customers does Ryan have left to help?

needs to help
30 customers

helps 27 customers

Number of customers Ryan needs to help:

Number of customers Ryan helps:

How many customers does Ryan have left to help?

	3	0
-	2	7

5/1/20

Copyright © 2020 n2y, LLC. All rights reserved.
Unique Learning System®, April 2020

NUMBER JOURNAL

Brent and Mary Beth are giving out deposit slips to customers at the bank. Brent gives out 44 deposit slips. Mary Beth gives out 18 deposit slips. How many more deposit slips does Brent give out than Mary Beth?

44 deposit slips

18 deposit slips

Number of deposit slips Brent gives out:

$$\begin{array}{r} 4\ 4 \\ \hline \end{array}$$

Number of deposit slips Mary Beth gives out:

$$\begin{array}{r} -\ 1\ 8 \\ \hline \end{array}$$

How many more deposit slips does Brent give out than Mary Beth?

$$\begin{array}{r} \_\ \_ \\ \hline \end{array}$$

5/1/20

Copyright © 2020 n2y, LLC. All rights reserved.
Unique Learning System®, April 2020

Dynamic Activity
Subtracting 2-Digit Numbers - Borrowing

9

NUMBER JOURNAL

Brent and Mary Beth are giving out deposit slips to customers at the bank. Brent gives out 92 deposit slips. Mary Beth gives out 39 deposit slips. How many more deposit slips does Brent give out than Mary Beth?

92 deposit slips

39 deposit slips

Number of deposit slips Brent gives out:

–	9	2
		–

Number of deposit slips Mary Beth gives out:

-	3	9

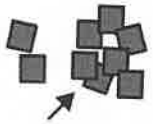

How many more deposit slips does Brent give out than Mary Beth?

Copyright © 2020 n2y, LLC. All rights reserved.
Unique Learning System®, April 2020

NUMBER JOURNAL

Mary Beth is sorting loan applications into piles at the bank.
She has 24 loan applications. She sorts 15 loan applications.
How many loan applications does Mary Beth have left to sort into piles?

has 24
loan applications

sorts 15
loan applications

Number of loan applications Mary Beth has:

$$\begin{array}{r} 2\ 4 \\ \hline \end{array}$$

Number of loan applications Mary Beth sorts:

$$\begin{array}{r} -\ 1\ 5 \\ \hline \end{array}$$

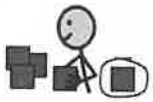

How many loan applications does Mary Beth have left to sort into piles?

$$\begin{array}{r} \_\ \_ \\ \hline \end{array}$$

5 | 1 | 20

Copyright © 2020 n2y, LLC. All rights reserved.
Unique Learning System®, April 2020

NUMBER JOURNAL

Ryan and Randy are stacking money envelopes at the bank.
Ryan stacks 68 money envelopes. Randy stacks 15 money envelopes.
How many more money envelopes does Ryan stack than Randy?

68 money envelopes

15 money envelopes

Number of money envelopes Ryan stacks: 68

Number of money envelopes Randy stacks: - 15

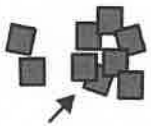

How many more money envelopes does Ryan stack than Randy? ___ ___

5/1/20

Copyright © 2020 n2y, LLC. All rights reserved.
Unique Learning System®, April 2020