Learning to Tell Time

Write the time under the first set of clocks. The first one has been done for you.



9:15





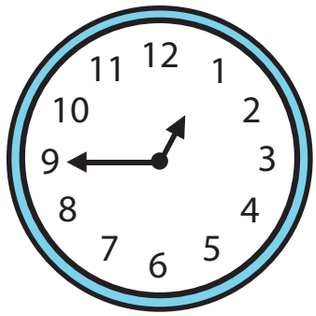









Now draw the hands on these analog clock faces to match the digital time already given.
The first one has been done for you.

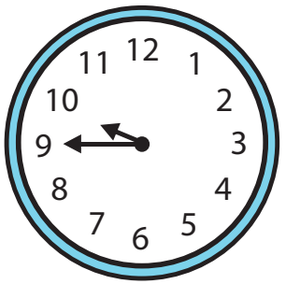

9:45



12:15



3:30



7:00



10:15



6:00

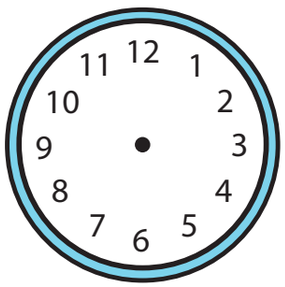

5:15



11:00

© 2007 - 2021 Education.com